Subtract Two Numbers (No Exchange)

1) Copy and complete the column subtractions.

a) 97 – 35 =

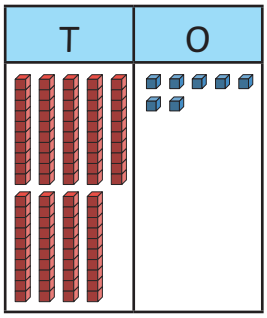

	T	O
	9	7
–	3	5

b) 343 – 113 =

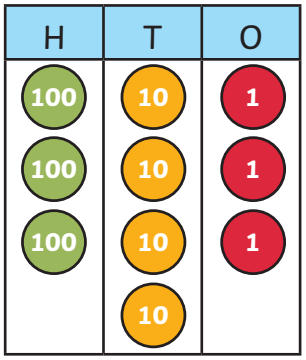

	H	T	O
	3	4	3
–	1	1	3

2) Work out the missing numbers.

a)

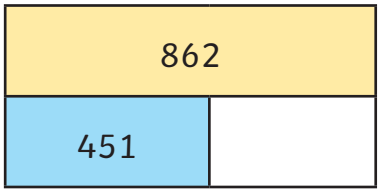

b)

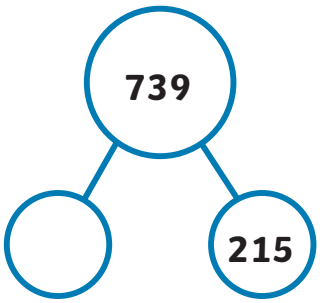

3) Use column subtraction to calculate the answers.

a) 834 – 615 =

b) 743 – 242 =

c) 957 – 642 =

d) 756 – 245 =

e) 381 – 231 =

f) 894 – 563 =



twinkl.com

Subtract Two Numbers (No Exchange)

1) Copy and complete the column subtractions.

a) 97 – 35 =

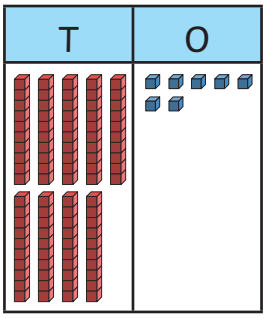

	T	O
	9	7
–	3	5

b) 343 – 113 =

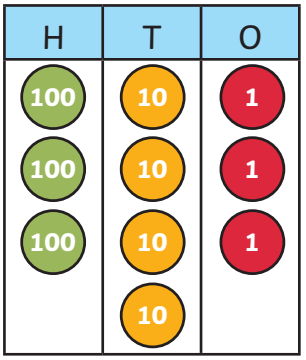

	H	T	O
	3	4	3
–	1	1	3

2) Work out the missing numbers.

a)

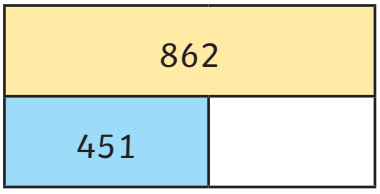

b)

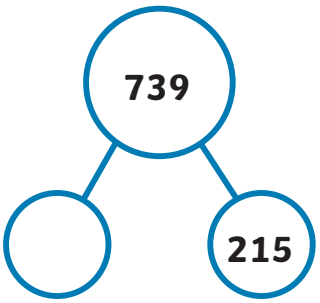

3) Use column subtraction to calculate the answers.

a) 834 – 615 =

b) 743 – 242 =

c) 957 – 642 =

d) 756 – 245 =

e) 381 – 231 =

f) 894 – 563 =



twinkl.com

Subtract Two Numbers (No Exchange)

1) Amrit is calculating 894 – 273. Can you spot and explain her mistake?



Amrit

	H	T	O
	2	7	3
–	8	9	4

2) True or false? The place value chart represents 532 – 321.

H	T	O
●●●●●	●●●	●●
●●●	●●	●

3) Which is the odd one out? Explain your reasoning.

a)

653	
443	

b)

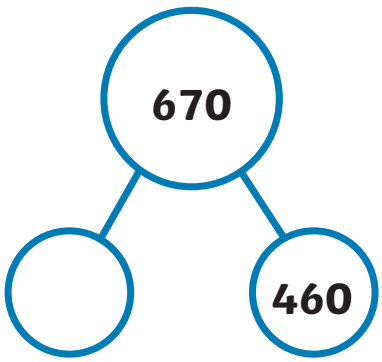

c) 856 – 636 =



Subtract Two Numbers (No Exchange)

1) Amrit is calculating 894 – 273. Can you spot and explain her mistake?



Amrit

	H	T	O
	2	7	3
–	8	9	4

2) True or false? The place value chart represents 532 – 321.

H	T	O
●●●●●	●●●	●●
●●●	●●	●

3) Which is the odd one out? Explain your reasoning.

a)

653	
443	

b)

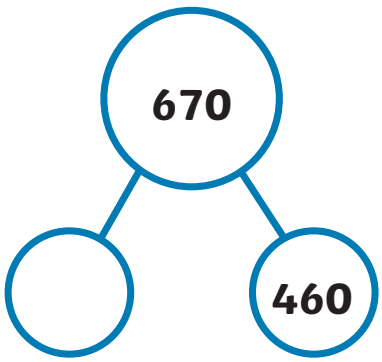

c) 856 – 636 =



twinkl.com

Subtract Two Numbers (No Exchange)

1)

a) What could the missing digits in the subtraction be? Find all possibilities.

	H	T	O
	5	9	☐
−	2	4	☐
	3	5	3

b) What is the pattern for the missing digits?

2) Joseph and Emily are both calculating a subtraction. Use the clues to work out Emily's subtraction.



Emily

I know that one of my numbers is 23.



Joseph

I am calculating 95 − 62.
My answer is half of Emily's.

3) What are the values of the shapes?

	H	T	O
	8	●	6
−	●	▲	▲
	■	3	4



twinkl.com

Subtract Two Numbers (No Exchange)

1)

a) What could the missing digits in the subtraction be? Find all possibilities.

	H	T	O
	5	9	☐
−	2	4	☐
	3	5	3

b) What is the pattern for the missing digits?

2) Joseph and Emily are both calculating a subtraction. Use the clues to work out Emily's subtraction.



Emily

I know that one of my numbers is 23.



Joseph

I am calculating 95 − 62.
My answer is half of Emily's.

3) What are the values of the shapes?

	H	T	O
	8	●	6
−	●	▲	▲
	■	3	4



twinkl.com